Sample Lesson

1. Write the number using base-ten numerals. 45 tens



2. Fill in the sign to make this sentence true. 312 ◯ 231

3. 566 − 243 = ?

4. There were 165 marbles in the jar. Jason gave 88 of those marbles to his friend Ryan. How many marbles are left in the jar?

5. 721 + 238 = ?



6. Count the objects in the array. Write an addition sentence to show the sum.

   _____ + _____ = _____

7. I have five hundreds, four tens, and six ones. What number am I?

8. It is 3:15 now. Draw hands on the clock showing this time.



9. The following measurements were collected by a second grade classroom. Use the data to create a line plot.

Crayon Lengths

Color	Length (cm)
Sky blue	10
Orange	5
Blue-green	8
Red	7
Yellow	6
Pink	8
Purple	6
Brown	8

10. A yardstick is 36 inches long. Renee put two yardsticks end to end. How long were the two yardsticks together?

11. 33 + 19 + 11 + 21 = ?

12. What is the name of the shape?

    cube cone cylinder

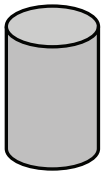

13. 35 + _____ = 80

14. Todd has his morning snack at 10:00 a.m. or 10:00 p.m.?

15. How long does Arts & Crafts last?

    If you went to all of the park's activities, how long would you be at the park?

Park Schedule

Time	Activity
1:30 – 2:00	Story Time
2:00 – 3:30	Arts & Crafts
3:30 – 4:30	Baseball

1. 2.NBT.3	**2.** 2.NBT.4	**3.** 2.NBT.7
4. 2.OA.1	**5.** 2.NBT.7	**6.** 2.OA.4
7. 2.NBT.3	**8.** 2.MD.7 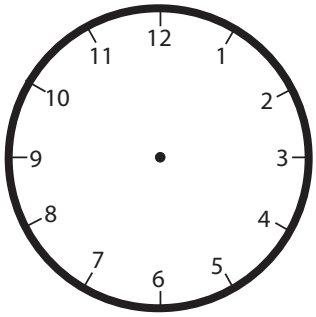	**9.** 2.MD.9 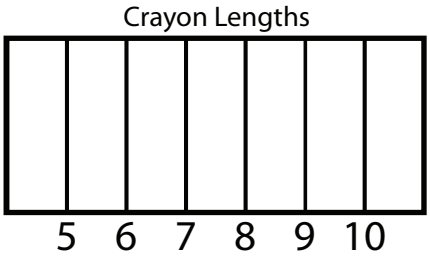
10. 2.MD.5	**11.** 2.NBT.6	**12.** 1.G.2
13. 2.OA.1	**14.** 2.MD.7	**15.** 2.MD.10